SATISH CHANDRA MEMORIAL SCHOOL

FINAL TERM EXAMINATION 2025 – 26

STD – I

SUBJECT : MATHEMATICS

80

Time – 3 hours Maximum Marks – 80

Name : _____ Roll No. _____ Sec:_____

Invigilator's Signature : _____ Date :_____

OBJECTIVE (40)

Case Study – 1 **(1 x 10 = 10)**

Today is Monday, 26th January. I went to the book fair with my father and my sister in the evening, after 6.00 p.m. My father gave me two notes of hundred rupees and one note of fifty rupees and one note of twenty rupees to my sister. I bought two story books for ₹ 100 while my sister purchased a drawing book for ₹ 50.

Read the above passage and tick the correct option:-

1) I had total ___ rupees.

a) ₹300 b) ₹200 c) ₹100 d) ₹150

2) I spent ___ to buy the storybooks.

a) ₹ 100 b) ₹ 60 c) ₹ 90 d) ₹ 80

3) The rectangular object mentioned in the passage is -

a) notse b) nates c) notes d) nutes

4) My sister and I spent total __ rupees.

a) (₹100 + ₹ 20) b) (₹100 + ₹ 30) c) (₹ 100 + ₹ 10) d) (₹ 50 + ₹ 100)

5) I have ___ rupees left with me after purchasing the story books.

a) ₹ 80 b) ₹ 100 c) ₹ 120 d) ₹ 110

6) We went to the book fair at –

a) b) c) d)

Rough _____

7) ₹ 70 = ₹ 50 + ____

a) ₹ 30 b) ₹ 40 c) ₹ 10 d) ₹ 20

8) What do you celebrate on 26th January?

a) Netaji Jayanti b) Independence Day c) Republic Day d) Christmas

9) Monday is the ____ day of the week.

a) second b) fourth c) third d) fifth

10) The cost of two drawing book ____

a) ₹ 110 b) ₹ 200 c) ₹ 100 d) ₹ 150

Case Study – 2 **(1 x 10 = 10)**

Today morning, my mother and my aunt went to the market. They returned home with two baskets filled with fruits and vegetables. Let's take a look at what they purchased and how much each item cost.



Observe the picture and tick the correct option:-

11) Mother wants to buy an apple and grapes. How much money does she need?

a) ₹ 90 b) ₹ 80 c) ₹ 60 d) ₹ 100

Rough _____

12) My aunt bought one mango. How much money did she pay?

a) (₹ 20 + ₹ 10) b) (₹ 10 + ₹ 10) c) (₹ 20 + ₹ 5) d) (₹ 5 + ₹ 5)

13) Which is the costliest fruit in the above picture?

a) mango b) grapes c) apple d) banana

14) If my mother give four coins of ₹2 each, which vegetable can she purchase?

a) brinjal b) carrot c) onion d) tomato

15) How many mangoes can be bought for ₹ 50?

a) one b) three c) four d) two

16) Which is the cheapest vegetable in the basket?

a) onion b) tomato c) brinjal d) carrot

17) My aunt gave ___ notes of ₹ 10 to buy three brinjals.

a) 2 b) 1 c) 3 d) 4

18) = _____

a) ₹ 70 b) ₹ 71 c) ₹ 72 d) ₹ 77

19) Name the vegetable which is violet in colour?

a) carrot b) brinjal c) tomato d) potato

20) What is the total cost of all the fruits and vegetables that are red in colour ?

a) ₹ 55 b) ₹ 51 c) ₹ 51 d) ₹ 52

General Math

Do as directed:- **(1 x 10 = 10)**

21) 3 less than (32 + 5) = _____

22) (11 x 6) - (12 x 0) = _____

Rough _____

23) (5 times 8) + (2 times 8) = _____

24) ₹ 15 + ₹20 + ₹5 + ₹1 = _____

25) (2 notes of 10 rupees) + (2 coins of 5 rupees) = _____

26) Double of 28 = _____

27) ₹ 200 = ₹ 100 + _____

28) Put the correct sign:- (> , < , =)

a) (12 times 4) [ ] (5 times 10)

29) The sum of 8, 9 and 7 = _____

30) A number more than (5 x 9) but less than (67 – 20) is _____

Mental Maths:- **(1 x 10 = 10)**

31) (12 x 6) = _____ tens and 2 ones

32)

6 + 6 + 6 = 18

3 times [ ] = 18

3 x 6 = 18

33) Which of the following shape has more sides? Triangle / Rectangle (tick)

34) (The product of 8 x 5) + (The sum of 4 + 8) = _____

35) What is the place value of 8 in 4 8 3 =_____

36) Three notes of 50 rupees = _____

37) (The sum of 25 and 25) = (The product of 5 and [ ])

38) If = ₹ 15 then,

+ [ ]

39) The number name of (127 + 232) = _____

Rough _____

40)

The time of the biggest clock is _____

Subjective – 40

41) **Multiplication as repeated addition**:- (3)

42) Match the following:- (3)

a) 4 coins of 10 rupees (3 3 + 3 0)

b) 9 times 7 (2 8 – 1 0)

c) The sum of 6, 3 and 9 2 notes of 20 rupees

43) Count the shape and write the number :- (2)

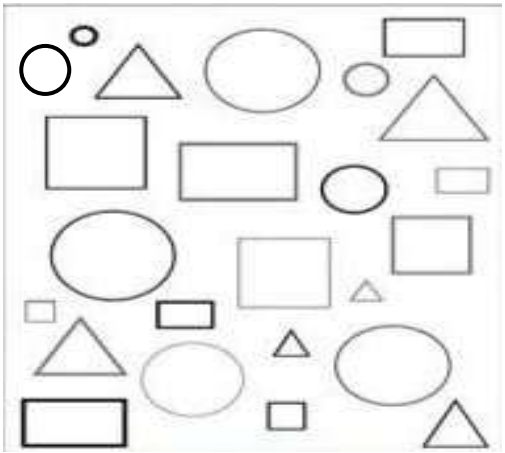



= _____

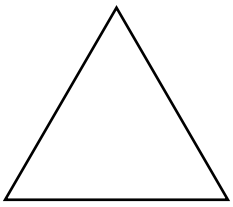

= _____

Rough _____

44) **Data Handling**:- (4)

Items	Number of children
Pencil	21
Crayon	14
Eraser	14
Pencil box	25

i) How many children have eraser? _____

ii) Count the total number of pencils and crayons that the children have _____

iii) Which item is more in number that the children have? _____

iv) _____ and _____ are equal .

45) **Reasoning:-** (2 + 2)

i) ◯ = 124

△ = 5 0

□ = 3 0 and

▭ = 4 5 then,

(△ + □) - (▭ - ▭) = ____

ii) Riddhi goes to school at 7 0' clock in the morning. He returns home after 4 hours. Write the time when Riddhi returns home? _____

46) **HOTS:-** (2 + 2)

i) I am greater than 260 but less than 300. My tens digit is (4 x 2) and ones digit is (5 – 5). I am _____

ii) If you have 3 notes of ₹20 each and 4 coins of ₹10 each, what is the total amount of money you have? _____

Rough _____

47) **General Math** :- (2+ 2+ 1 = 5)

a) Today Madhu went to her uncle's farm and saw many animals there. She liked the hens on the farm . She collected 15 eggs from their coop and brought them home. Later , she noticed that 5 of the eggs were broken. How many eggs were left? _____

b) Draw a clock (circular shaped) and show the time given below:-

11 0' clock

c) 12 + 18 + 10 + 14 + 13 + 11 = _____

48) **Word problem**:- (15)

i) There were 69 sandesh in the fridge. Suddenly , some guests came and mother gave them 28 sandesh. How many sandesh were left in the fridge?

ii) Manav had ₹ 45 . His mother gave him ₹ 30 more. How much money does he have now?

Rough _____

iii) A train compartment has 75 seats . 20 seats were occupied by the passengers. Find the number of seats are empty?

iv) In a packet , there are 29 pencils. Riya uses 9 pencils. How many pencils are left in the packet?

v) Arin bought 456 bottles of milk and sold 204 bottles. How many bottles of milk are left with him?

Rough _____